Namn: _____ Datum: _____

Tiokamrater med tioruta

Räkna prickarna. Hur många fattas till tio? Rita prickarna som fattas och skriv talet.

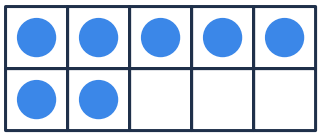

7 + ☐ = 10

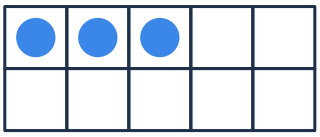

3 + ☐ = 10

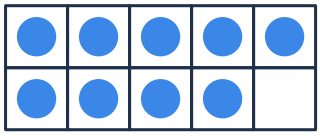

9 + ☐ = 10

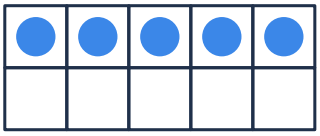

5 + ☐ = 10



1 + ☐ = 10

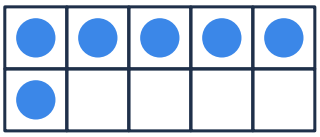

6 + ☐ = 10

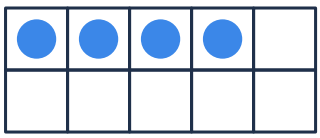

4 + ☐ = 10

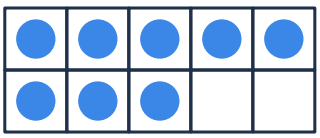

8 + ☐ = 10

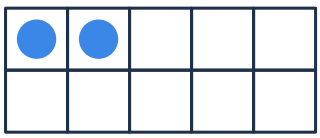

2 + ☐ = 10



0 + ☐ = 10

© Klassblad.se | Får kopieras för undervisning

Facit – Tiokamrater med tioruta

Rätt svar till arbetsbladet.

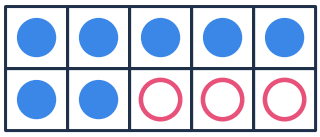

7 + 3 = 10

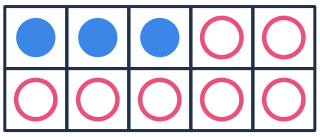

3 + 7 = 10

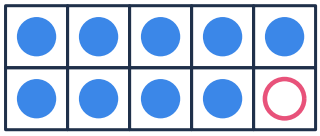

9 + 1 = 10

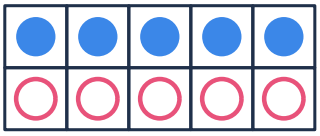

5 + 5 = 10

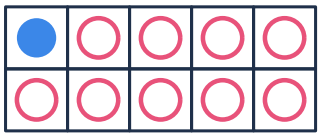

1 + 9 = 10

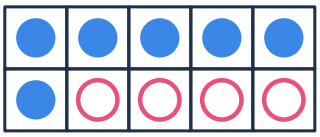

6 + 4 = 10

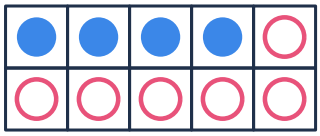

4 + 6 = 10



8 + 2 = 10



2 + 8 = 10



0 + 10 = 10

© Klassblad.se | Får kopieras för undervisning